2D shapes worksheet

Years 1 and 2. Write the name of each shape and how many straight sides it has.

Name: _____ Date: _____



Name: _____

Straight sides: _____

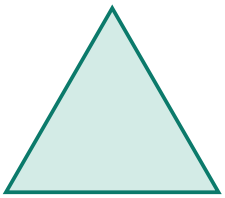

Name: _____

Straight sides: _____



Name: _____

Straight sides: _____



Name: _____

Straight sides: _____

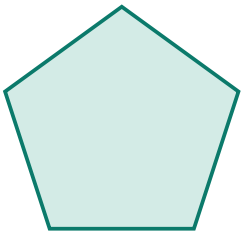

Name: _____

Straight sides: _____

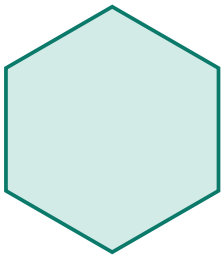

Name: _____

Straight sides: _____

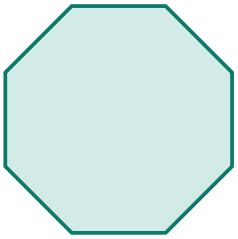

Name: _____

Straight sides: _____



Name: _____

Straight sides: _____

Challenge: which of these shapes has a curved side and a straight side?

_____

Answer key: 2D shapes

Answers. A circle has one curved side and no straight sides; a semicircle has one curved and one straight side.

Name: **circle**

Straight sides: **0**

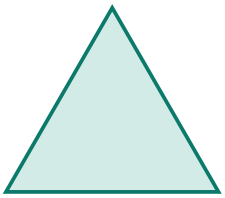

Name: **triangle**

Straight sides: **3**



Name: **square**

Straight sides: **4**



Name: **rectangle**

Straight sides: **4**

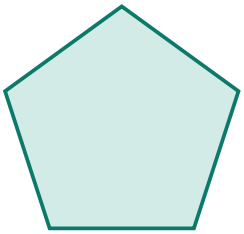

Name: **pentagon**

Straight sides: **5**

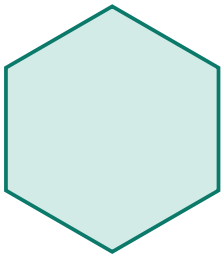

Name: **hexagon**

Straight sides: **6**

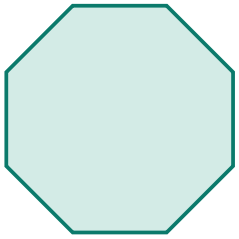

Name: **octagon**

Straight sides: **8**



Name: **semicircle**

Straight sides: **1**

Challenge: which of these shapes has a curved side and a straight side?

The semicircle (number 8).