Percentages on a hundred square

Years 5 and 6. Squares 1 to 3: shade the percentage. Squares 4 to 6: write the percentage, fraction and decimal that is shaded.

Name: _____ Date: _____



Shade 33%



Shade 88%



Shade 81%



____ % ____ / ____ 0.____



____ % ____ / ____ 0.____



____ % ____ / ____ 0.____

Answer key: Percentages on a hundred square

Answers to every question on page 1.



Shade 33%



Shade 88%



Shade 81%



25% = 1/4 = 0.25



28% = 7/25 = 0.28



19% = 19/100 = 0.19