# Area and perimeter by counting squares

Years 3 and 4. Each square is 1 cm by 1 cm. Count squares for the area and count the outside edges for the perimeter.

Name: _____ Date: _____

**1.**

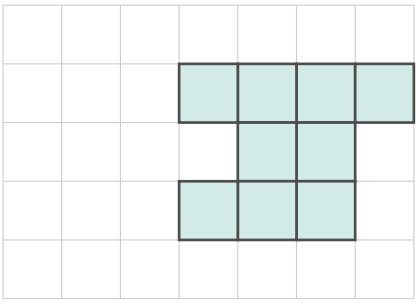

Area: _____ cm² Perimeter: _____ cm

**2.**

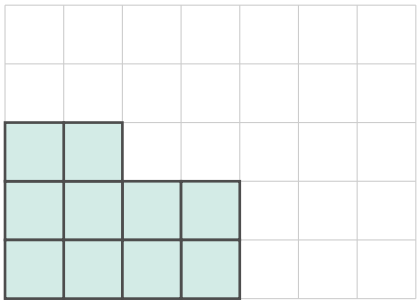

Area: _____ cm² Perimeter: _____ cm

**3.**

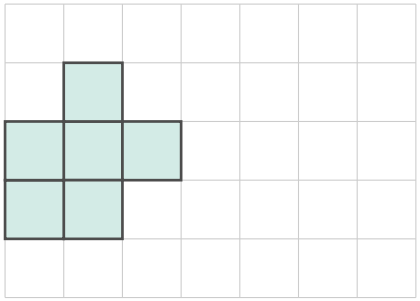

Area: _____ cm² Perimeter: _____ cm

**4.**

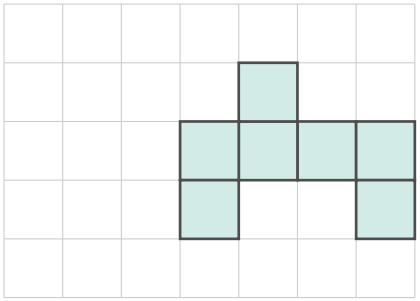

Area: _____ cm² Perimeter: _____ cm

**5.**

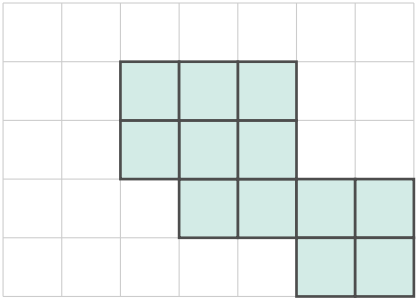

Area: _____ cm² Perimeter: _____ cm

**6.**

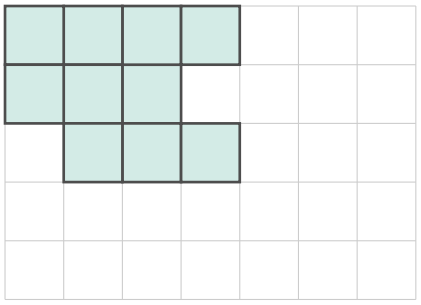

Area: _____ cm² Perimeter: _____ cm

# Answer key: Counting squares

Answers to every question on page 1.

**1.**

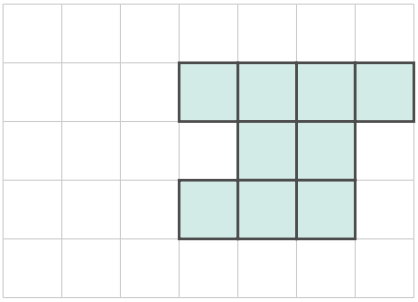

**Area: 9 cm²** **Perimeter: 16 cm**

**2.**

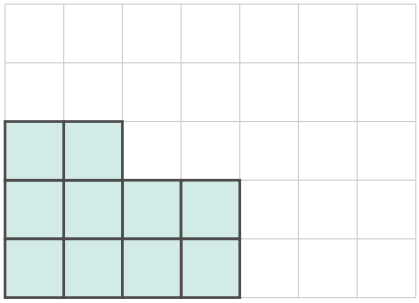

**Area: 10 cm²** **Perimeter: 14 cm**

**3.**

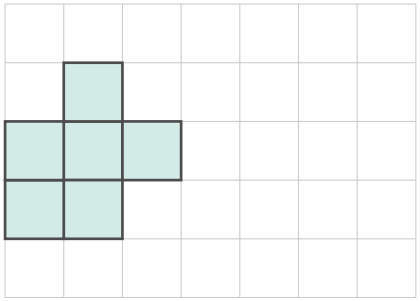

**Area: 6 cm²** **Perimeter: 12 cm**

**4.**

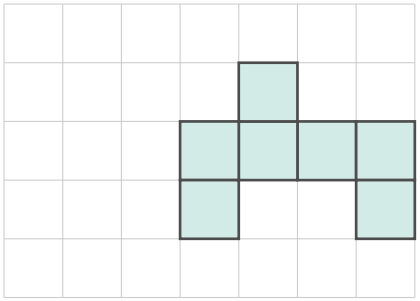

**Area: 7 cm²** **Perimeter: 16 cm**

**5.**

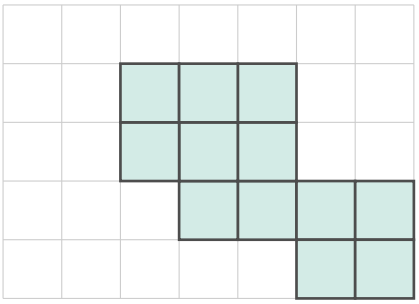

**Area: 12 cm²** **Perimeter: 18 cm**

**6.**

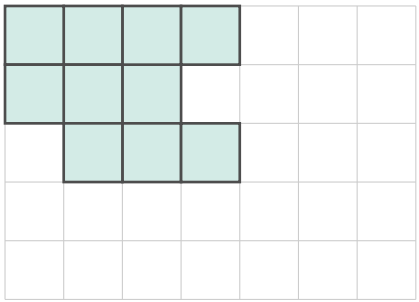

**Area: 10 cm²** **Perimeter: 16 cm**