Polygons worksheet

Years 4 to 6. Name each polygon by its number of sides, then write whether it is regular or irregular.

Name: _____ Date: _____

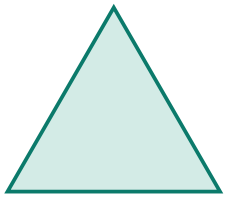

1. Name: _____

Regular? _____

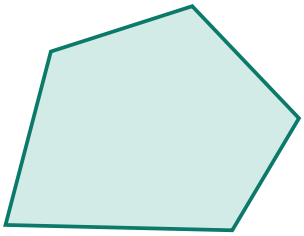

2. Name: _____

Regular? _____



3. Name: _____

Regular? _____

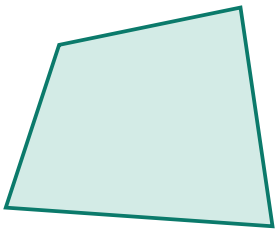

4. Name: _____

Regular? _____

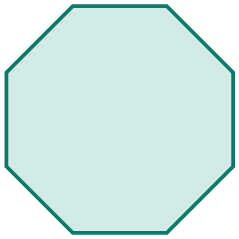

5. Name: _____

Regular? _____

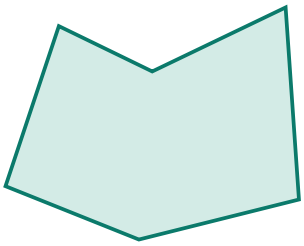

6. Name: _____

Regular? _____

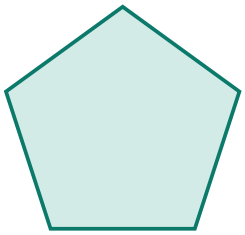

7. Name: _____

Regular? _____

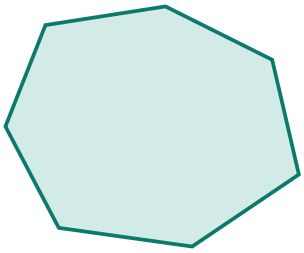

8. Name: _____

Regular? _____

Answer key: Polygons

Regular polygons have all sides equal and all angles equal.

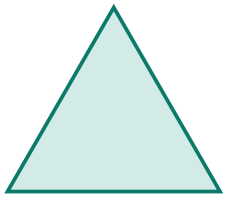

1. Name: **triangle**

Regular? **regular**

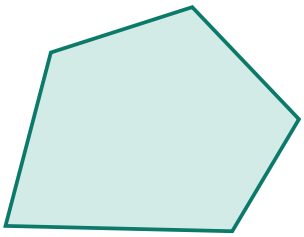

2. Name: **pentagon**

Regular? **irregular**



3. Name: **hexagon**

Regular? **regular**

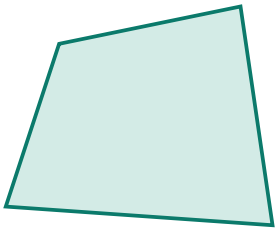

4. Name: **quadrilateral**

Regular? **irregular**

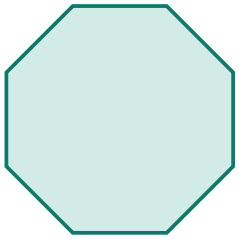

5. Name: **octagon**

Regular? **regular**

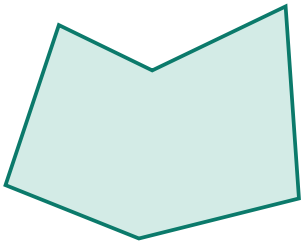

6. Name: **hexagon**

Regular? **irregular**

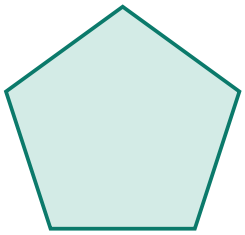

7. Name: **pentagon**

Regular? **regular**

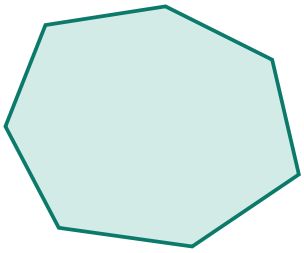

8. Name: **heptagon**

Regular? **irregular**