Quadrilaterals worksheet

Years 4 to 6. Name each quadrilateral, then complete the table of properties.

Name: _____ Date: _____



A. _____



B. _____



C. _____



D. _____



E. _____



F. _____

Shape	4 equal sides?	4 right angles?	Pairs of parallel sides
square			
rectangle			
rhombus			
parallelogram			
trapezium			
kite			

Answer key: Quadrilaterals

Answers. A square is also a rectangle and a rhombus.



A. **square**



B. **rectangle**



C. **rhombus**



D. **parallelogram**

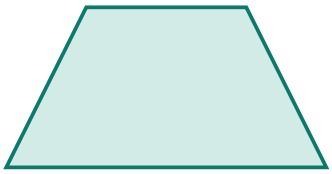

E. **trapezium**



F. **kite**

Shape	4 equal sides?	4 right angles?	Pairs of parallel sides
square	yes	yes	2
rectangle	no	yes	2
rhombus	yes	no	2
parallelogram	no	no	2
trapezium	no	no	1
kite	no	no	0